The 23rd Annual
Dr. Feinberg Geography Challenge
Study Book

Grade 2

Spring 2018



Mary Lee Burbank School
266 School Street
Belmont, Massachusetts 02478
U.S.A.

Dr. Tricia Clifford, Principal

Parents: Please review this with your child.

March 2018

Dear Burbank Grade 2 Students:

The Dr. Feinberg Geography Challenge for the Junior Division (Students in Grades K, 1, and 2) will take place on the morning of Thursday, March 22nd, in the Burbank cafeteria. **The Grade 2 Challenge will be from 10-10:30am, after the K-1 students depart.** Your parents or guardians, grandparents and special friends or neighbors are welcome to attend the Challenge.

All of the questions and answers for the Challenge are found in this book. At the Challenge your team will be asked a few of the questions from the guide. **Your final question will be a flag.** We encourage you to study the questions both alone and with your teammates. All questions will be directed to your team, not to you as an individual. **Don't forget to coordinate with your team on a theme or color to wear the day of the Challenge.**

The purpose of the Challenge is to learn and have fun. You may find that some of the questions are easiest to learn by using a map or atlas to find locations and features. If you are able to understand how locations relate to one another, you may be able to avoid simply memorizing some of the answers, and you may be better able to remember what you have learned even after the Challenge is over.

Congratulations to all of you who have decided to participate in the Challenge this year! If you have any questions, please contact one of the committee chairs.

Good luck!

Sincerely,

Clare Crawford, crawfocl@yahoo.com
Kathy Collins DerKazarian, kaceycoll@yahoo.com
Aida Parnagian, aida0519@yahoo.com
Irina Zhygalko, irina.zhygalko@gmail.com

PTA Geography Challenge Co-Chairs

Dr. Feinberg Geography Challenge 2018
Grade 2 Questions

The World

1. Q: What is the largest island in the world?
   A: Greenland (about 840,000 square miles)

2. Q: Name five of the seven continents in the world.
   A: Asia, Africa, North America, South America, Europe, Australia and Antarctica

3. Q: This country is the second largest in the world by size, and also has the longest coastline in the world. Name it.
   A: Canada

4. Q: What is the deepest point in the Ocean?
   A: Marianas Trench

5. Q: What is the name of the cape at the southern tip of Africa?
   A: Cape of Good Hope

6. Q: On which continent would you find Egypt?
   A: Africa

7. Q: A canal is a man-made waterway that is built for transportation. Name the canal that connects the Mediterranean Sea and the Red Sea.
   A: Suez Canal

8. Q: Water covers what percentage of the earth's surface?
   A: About 70%

9. Q: Name the lowest point on Earth.
   A: Dead Sea

10. Q: Does the equator run thorough North America, Central America or South America?
    A: South America

11. Q: The Galapagos Islands lie off the western coast of which South American country?
    A: Ecuador

Kenya

12. Q: What is the capital of Kenya?
    A: Nairobi

13. Q: What are the two main languages in Kenya?
    A: Swahili and English

14. Q: The largest lake in Africa lies within Uganda, Kenya and Tanzania. What is its name?
    A: Lake Victoria

15. Q: What is the unit of currency in Kenya?
A. The Kenyan Shilling

Alaska

16. Q: What is the highest mountain in North America?
A: Denali (formerly Mt. McKinley)

17. Q: What country did the United States purchase Alaska from in 1867?
A: Russia

18. Q: In what year did Alaska become a state?
A: 1959

19. Q: What is featured on the Alaskan flag?
A: The Big Dipper and the North Star

20. Q: What country borders Alaska to the east?
A: Canada

21. Q: What is the Alaskan state bird?
A: Willow Ptarmigan

22. Q: Name the towns at the start and finish of the Iditarod Dog Sled Race
A: Anchorage and Nome

New England and Massachusetts

23. Q: Massachusetts has 14 counties. Name the county in which Belmont is located.
A: Middlesex

24. Q: The Basketball Hall of Fame is located in what Massachusetts city?
A: Springfield

25. Q: What is the name of the river that flows through the three New Hampshire cities of Concord, Manchester, and Nashua?
A: The Merrimack River

26. Q: There are six New England states. Name any two.
A: Connecticut, Maine, Massachusetts, New Hampshire, Rhode Island and Vermont

27. Q: In which Massachusetts town does the Charles River start? This town is also where the Boston Marathon starts.
A: Hopkinton

28. Q: What is the state dog of Massachusetts?
A: Boston Terrier

Belmont

29. Q. What is the name of the first public outdoor swimming pool in the country?
    A: The Underwood Pool

30. Q: What fruit was celebrated in Belmont with its own festival?
    A: Strawberry

31. Q: What is the original meaning of the name Belmont?
    A: Beautiful Mountain

32. Q: In what year did Belmont become a town?
    A: 1859

33. Q: There are three business districts in Belmont. Name one.
    A: Belmont Center, Cushing Square, Waverly Square

Geographical Terms and Features

34. Q: What are the grasslands that cover the central part of the United States called?
    A: Prairies

35. Q: What is the name of someone who draws maps?
    A: Cartographer

36. Q: This appears on maps to explain all the symbols. What is it called?
    A: A key or a legend

37. Q: What is another name for the Aurora Borealis, the spectacular colored lights that appear in the night sky in the far Northern Hemisphere?
    A: The Northern Lights

38. Q: What is the name of the unmanned spacecraft placed in orbit around the Earth? Pictures taken from these spacecraft are an important source of information for mapmakers.
    A: Satellite

39. Q: What is the name of the molten rock that lies beneath the surface of the earth?
    A: Magma

40. Q: What is the word for the height of land in relation to sea level?
    A: Altitude (or elevation)

Bonus Question

Q: Who is Dr. Feinberg and why is the Geography Challenge named after her?

A: She was a previous Principal of the Burbank school and she started the Geography Challenge 23 years ago.

FLAGS

Identify these flags:

Greece:

Morocco:

Kenya:



Panama:

Australia:



Nicaragua: